Snowman Addition



Name _____

Draw both snowball groups in the frame. Write the total.





2 + 3 = ☐

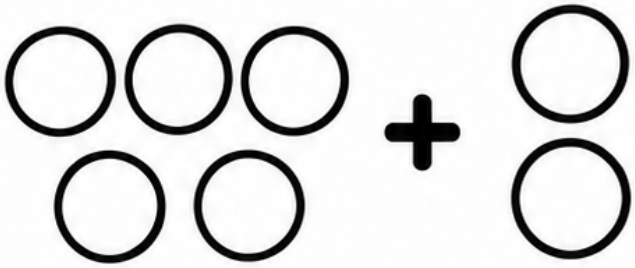



5 + 2 = ☐

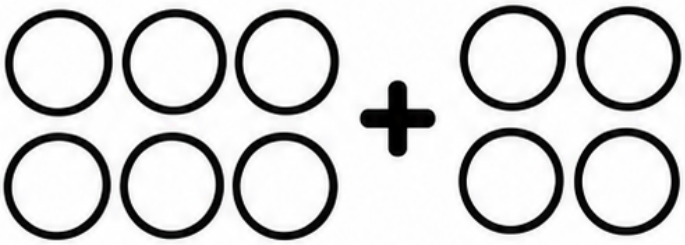



6 + 4 = ☐